Name : _____ Score : _____

Teacher : _____ Date : _____

Find the measure of the missing angle.

1)

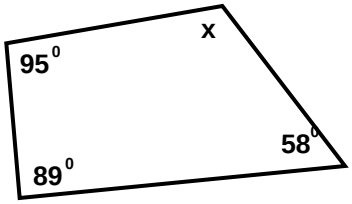

Solve for x _____

2)

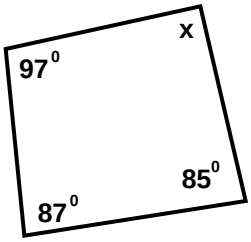

Solve for x _____

3)

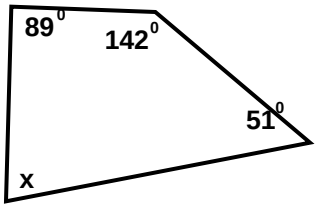

Solve for x _____

4)

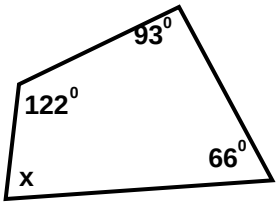

Solve for x _____

5)

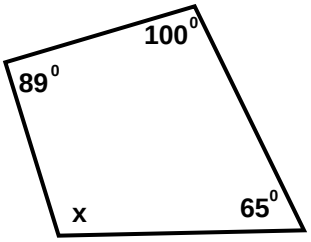

Solve for x _____

6)

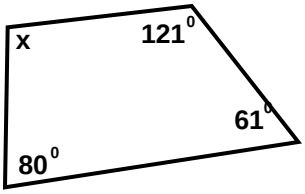

Solve for x _____

7)

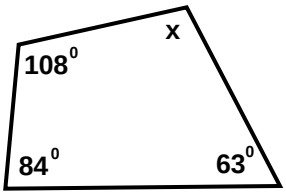

Solve for x _____

8)

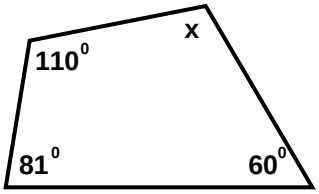

Solve for x _____

9)

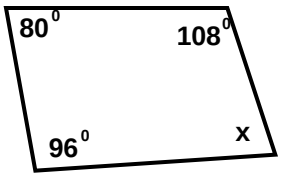

Solve for x _____

10)

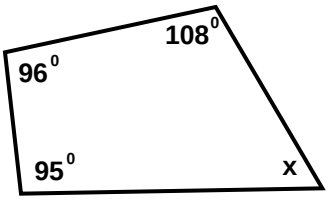

Solve for x _____

11)

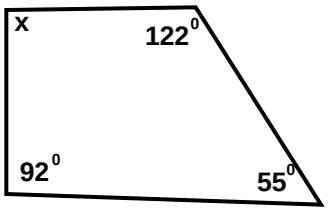

Solve for x _____

12)

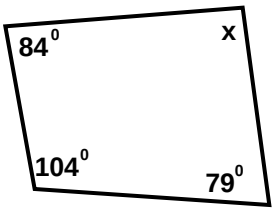

Solve for x _____

Name : _____ Score : _____

Teacher : _____ Date : _____

Find the measure of the missing angle.

1)

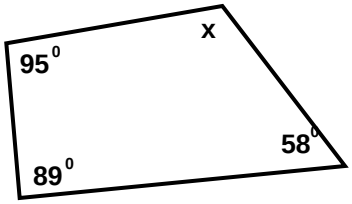

Solve for x 118°

2)

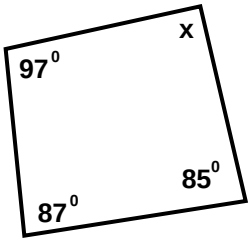

Solve for x 91°

3)

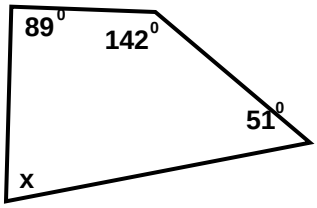

Solve for x 78°

4)

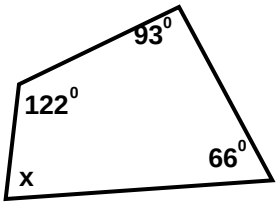

Solve for x 79°

5)

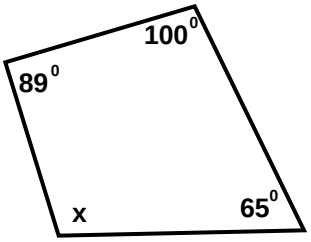

Solve for x 106°

6)

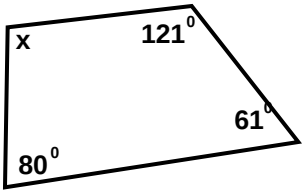

Solve for x 98°

7)

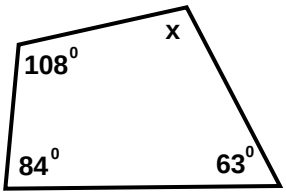

Solve for x 105°

8)

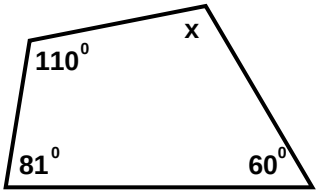

Solve for x 109°

9)

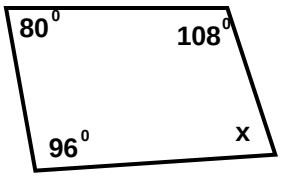

Solve for x 76°

10)

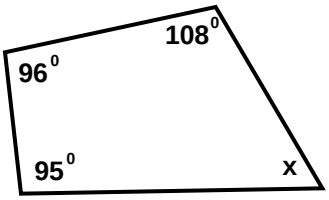

Solve for x 61°

11)

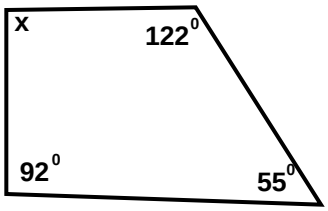

Solve for x 91°

12)

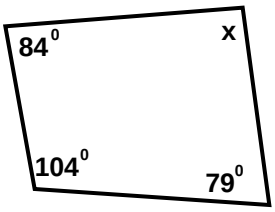

Solve for x 93°